Homework Assignment 5C2

(To be used following Lesson 16)

Name: _____ Date: _____

1. Shade each circle to represent the percent. Write an equivalent fraction and decimal.

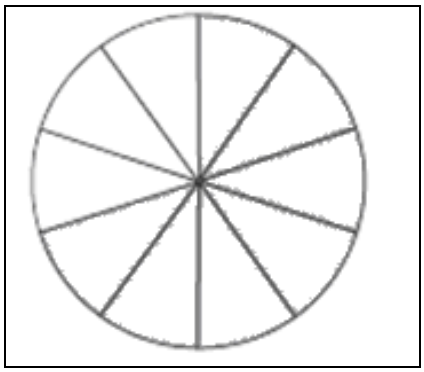	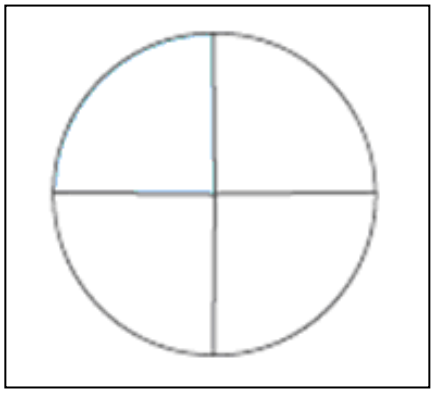	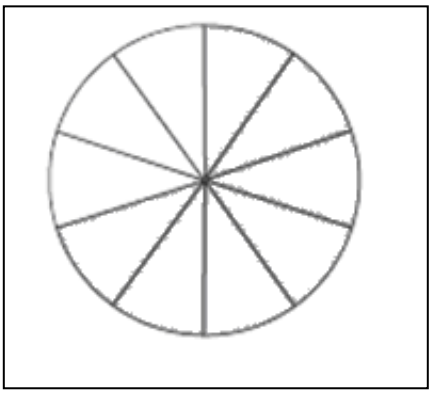
20%	50%	30%
Percent Fraction Decimal	Percent Fraction Decimal	Percent Fraction Decimal

2. Represent 80% in a drawing and write a description of 80%.

3. Solve each problem by representing it in a percent grid. Write a description of the solution.

Problem A

Mrs. King found a sale on printers. The regular price was $450. What was the cost of a printer if the price was reduced by 15%?



Problem B

A watch is marked down 45% from its regular price of $62. What is the sale price of the watch?